Recognise and describe 2D shapes

1 Match the shapes to the labels.

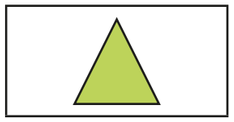

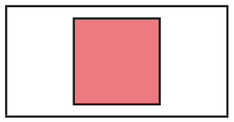

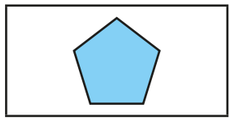

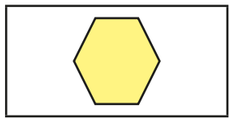

square

pentagon

triangle

hexagon

2 Use the words to label the shapes.

rectangle | hexagon | circle | triangle | pentagon

a)



_____

b)

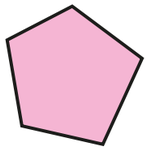

_____

c)

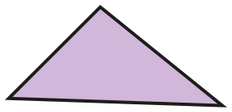

_____

d)

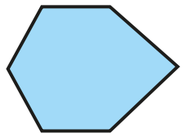

_____

3 Dora and Ron each have a shape.

a)

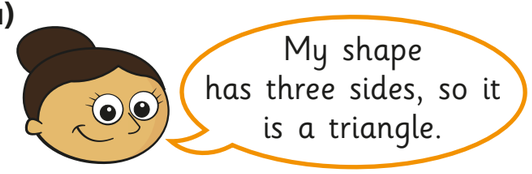

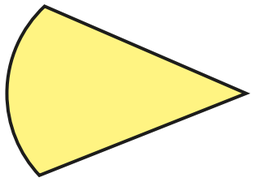

Why is Dora incorrect?

_____

_____

b)



Why might Ron think that? Talk to a partner.

What is the mathematical name for Ron's shape?

_____

4 Here are some shapes.

a) Circle all the quadrilaterals.





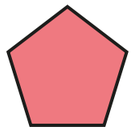

© White Rose Maths 2020

b) Draw three more quadrilaterals.

What do you notice about all the shapes you have drawn?

c) Is this shape a square?

Circle your answer. **yes** **no**

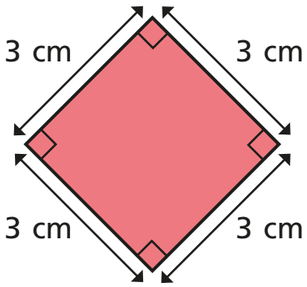

Compare answers with a partner.

5 This shape is a hexagon.

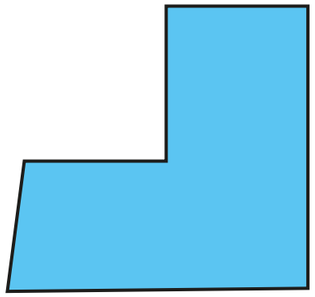

Why is it a hexagon?

_____

_____

6 What is the name of each shape?

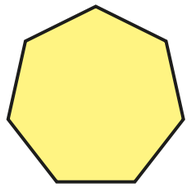

_____

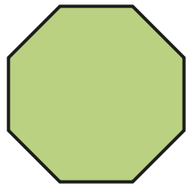

_____

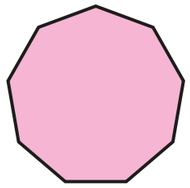

_____

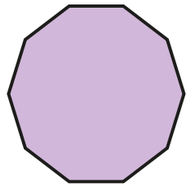

_____

How do you know? Talk about it with a partner.

7 Each shape has at at least one pair of parallel sides.

Draw on the shapes to show the parallel sides.

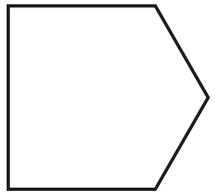

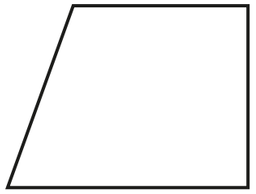

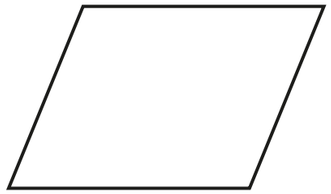

© White Rose Maths 2020